# L'échelle de Beaufort

Pour chaque illustration, indique la force de l'échelle de Beaufort qui correspond :

force .....

force .....



force .....

force .....

force .....



force .....

force .....

force .....

force .....

force .....

force .....

force .....

La Météo des Écoles

force .....

# L'échelle de Beaufort

## SOLUTION

Pour chaque illustration, indique la force de l'échelle de Beaufort qui correspond :

force **5**

force **4**



force **3**

force **12**

force **7**



force **1**

force **2**

force **10**

force **11**

force **9**

force **0**

force **6**

La Météo des Écoles

force **8**